2 Complete the additions.

a) $1\frac{2}{5} + 2\frac{3}{10} =$ ☐

b) $2\frac{2}{5} + 2\frac{3}{10} =$ ☐

c) $1\frac{3}{4} + 3\frac{3}{20} =$ ☐

e) $4\frac{1}{4} + 2\frac{11}{16} =$ ☐

d) $1\frac{3}{16} + 4\frac{3}{4} =$ ☐

f) $1\frac{4}{15} + 3\frac{2}{3} =$ ☐

3

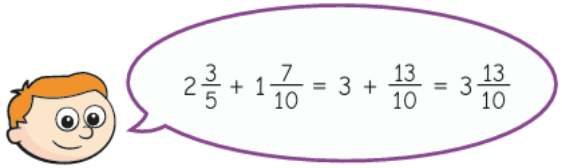

How can Ron improve his answer?

4 Complete the additions.

a) $2\frac{3}{4} + 3\frac{5}{12} =$ ☐

c) $5\frac{1}{6} + 3\frac{11}{12} =$ ☐

b) $3\frac{2}{3} + 2\frac{7}{12} =$ ☐

d) $6\frac{7}{15} + 3\frac{3}{5} =$ ☐

5 A blue ribbon is $2\frac{4}{9}$ m long.

A yellow ribbon is $3\frac{2}{3}$ m long.

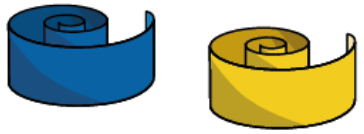

a) What is the total length of the blue and yellow ribbons?

☐ m

b) A red ribbon is $1\frac{5}{18}$ m longer than the yellow ribbon.

How long is the red ribbon?



☐ m

6 Work out the perimeter of the triangle.

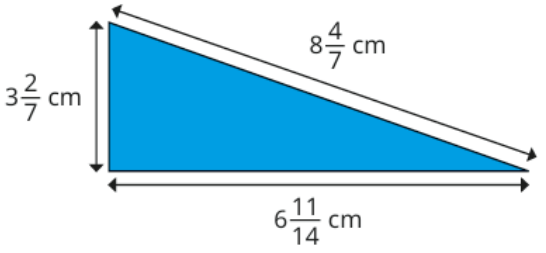

☐ cm